| Compétence travaillée | Difficulté | Socle commun | Nombre d'erreurs |
|---|---|---|---|
| Placer des points sur un axe gradué | ★☆☆☆☆ | ✔ | |

Placer les points dont les abscisses sont indiquées sur les axes gradués

1)

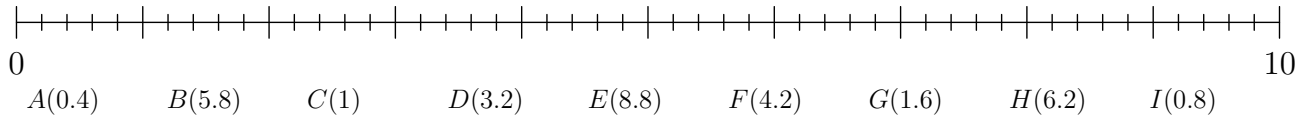


$A(0.4)$ $B(5.8)$ $C(1)$ $D(3.2)$ $E(8.8)$ $F(4.2)$ $G(1.6)$ $H(6.2)$ $I(0.8)$

2)

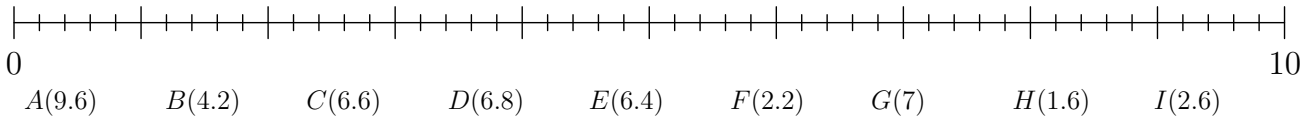


$A(9.6)$ $B(4.2)$ $C(6.6)$ $D(6.8)$ $E(6.4)$ $F(2.2)$ $G(7)$ $H(1.6)$ $I(2.6)$

3)

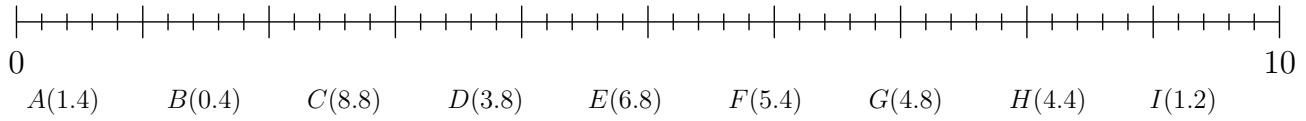


$A(1.4)$ $B(0.4)$ $C(8.8)$ $D(3.8)$ $E(6.8)$ $F(5.4)$ $G(4.8)$ $H(4.4)$ $I(1.2)$

4)

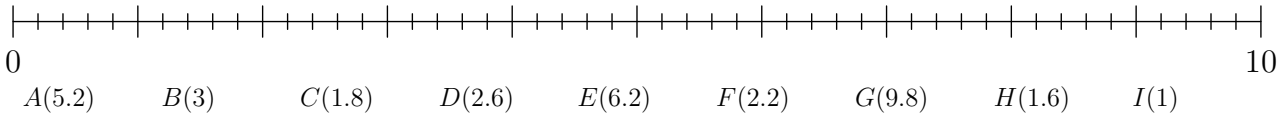


$A(5.2)$ $B(3)$ $C(1.8)$ $D(2.6)$ $E(6.2)$ $F(2.2)$ $G(9.8)$ $H(1.6)$ $I(1)$

5)

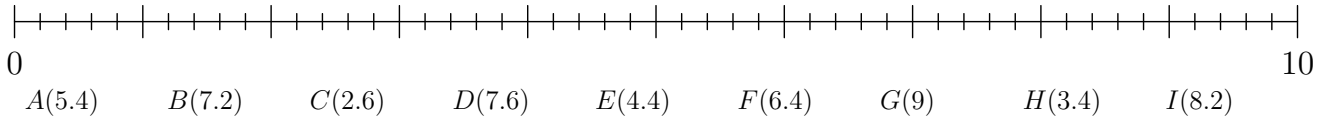


$A(5.4)$ $B(7.2)$ $C(2.6)$ $D(7.6)$ $E(4.4)$ $F(6.4)$ $G(9)$ $H(3.4)$ $I(8.2)$

6)

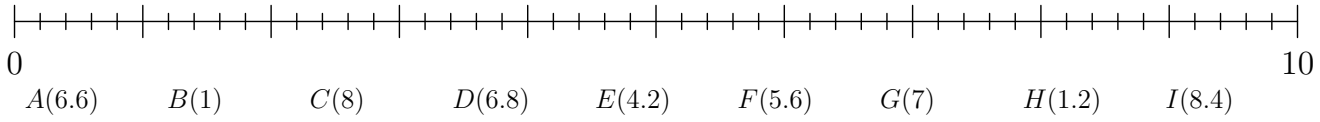


$A(6.6)$ $B(1)$ $C(8)$ $D(6.8)$ $E(4.2)$ $F(5.6)$ $G(7)$ $H(1.2)$ $I(8.4)$

1)

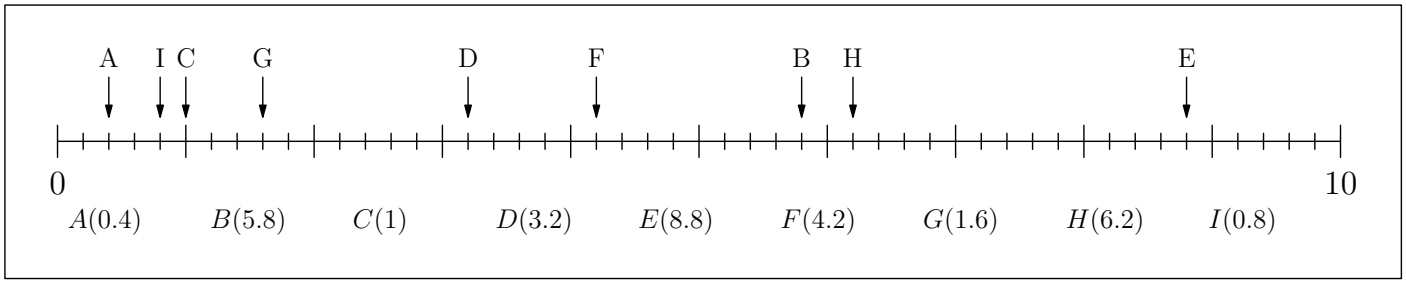
A I C G D F B H E
0
10
A(0.4) B(5.8) C(1) D(3.2) E(8.8) F(4.2) G(1.6) H(6.2) I(0.8)

2)

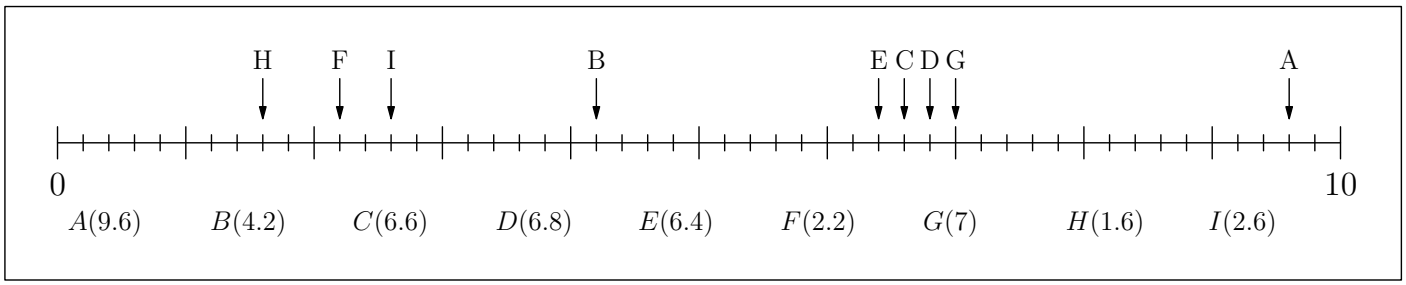
H F I B E C D G A
0
10
A(9.6) B(4.2) C(6.6) D(6.8) E(6.4) F(2.2) G(7) H(1.6) I(2.6)

3)

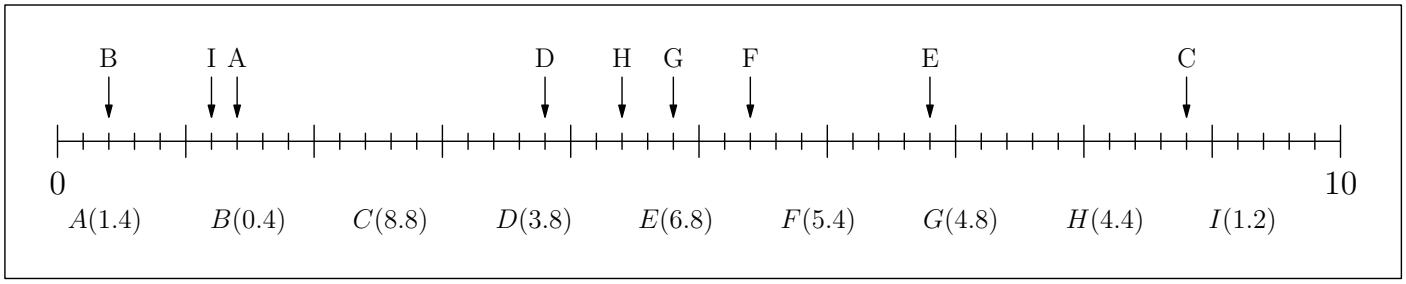
B I A D H G F E C
0
10
A(1.4) B(0.4) C(8.8) D(3.8) E(6.8) F(5.4) G(4.8) H(4.4) I(1.2)

4)

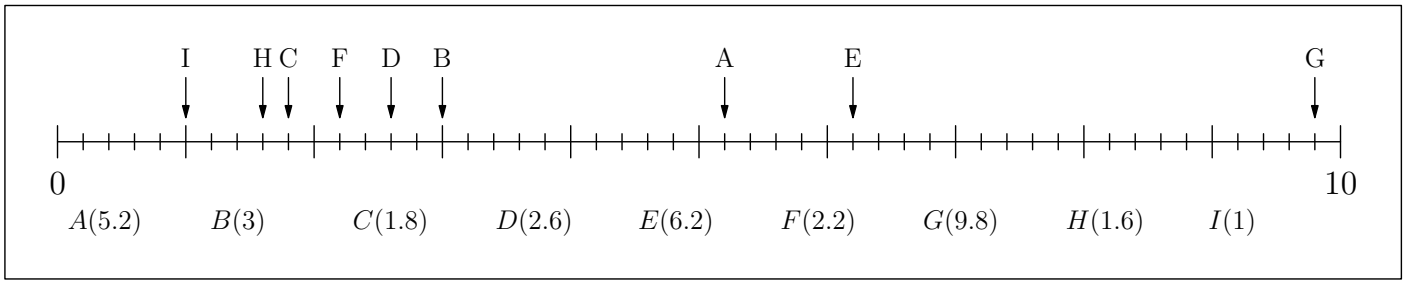
I H C F D B A E G
0
10
A(5.2) B(3) C(1.8) D(2.6) E(6.2) F(2.2) G(9.8) H(1.6) I(1)

5)

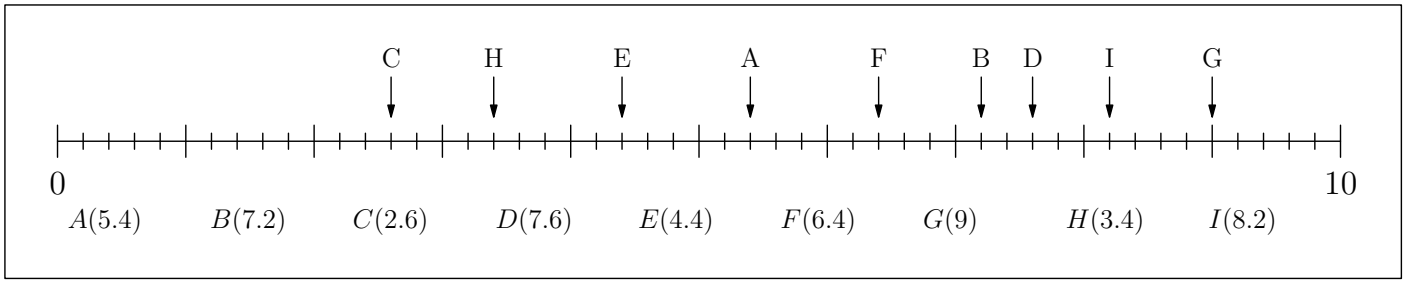
C H E A F B D I G
0
10
A(5.4) B(7.2) C(2.6) D(7.6) E(4.4) F(6.4) G(9) H(3.4) I(8.2)

6)

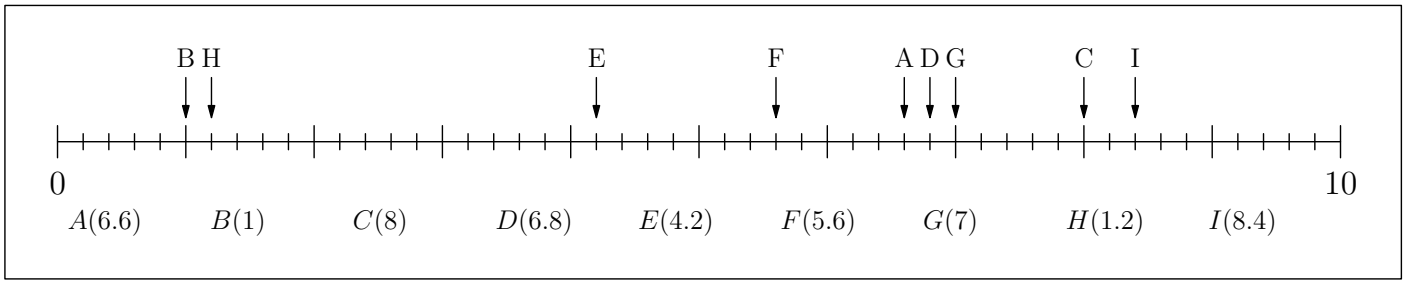
B H E F A D G C I
0
10
A(6.6) B(1) C(8) D(6.8) E(4.2) F(5.6) G(7) H(1.2) I(8.4)